くみ	ばん	なまえ

❹ のこりは　いくつ　ちがいは　いくつ

1　えを　みて，□に　すうじを　かきましょう。

①



3 － □ ＝ □

②



3 － □ ＝ □

③

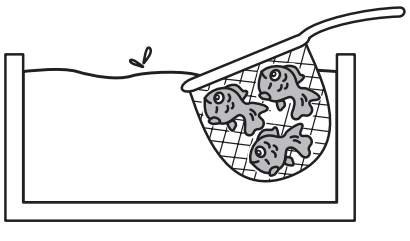

□ － □ ＝ □

④

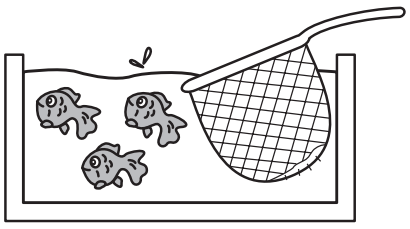

□ － □ ＝ □

2　ひきざんを　しましょう。

6－1	10－4	5－0
9－5	7－7	10－6
7－5	8－0	0－0
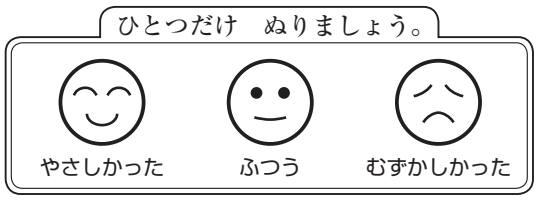
ひとつだけ　ぬりましょう。